네모로직

5단계 어려움 · 1번

이름 _____ 날짜 _____

줄마다 적힌 숫자만큼 칸을 이어서 칠하세요. 숫자가 둘 이상이면 사이를 한 칸 이상 띄웁니다.

1.

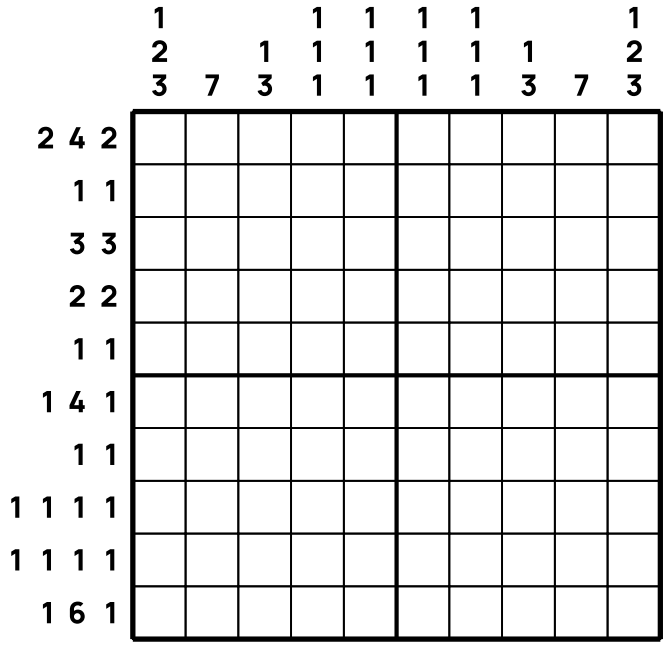

2.

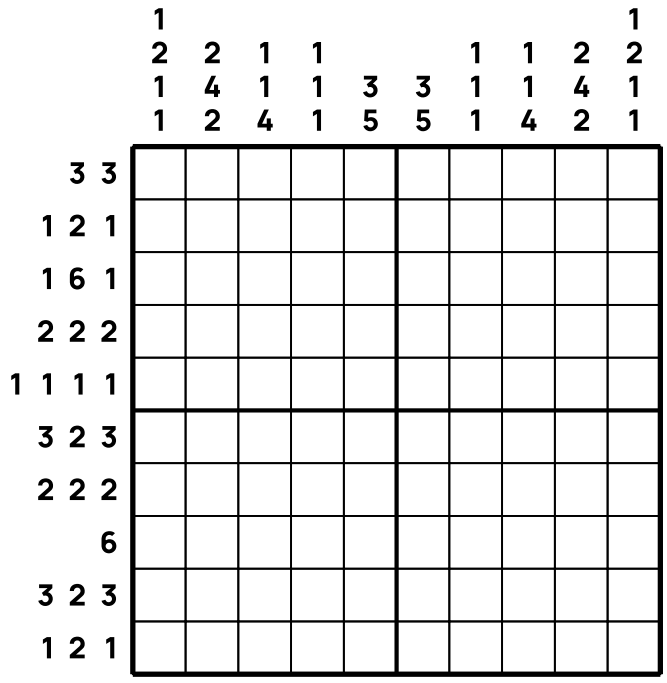

네모로직

5단계 어려움 · 2번

이름 _____ 날짜 _____

줄마다 적힌 숫자만큼 칸을 이어서 칠하세요. 숫자가 둘 이상이면 사이를 한 칸 이상 띄웁니다.

1.

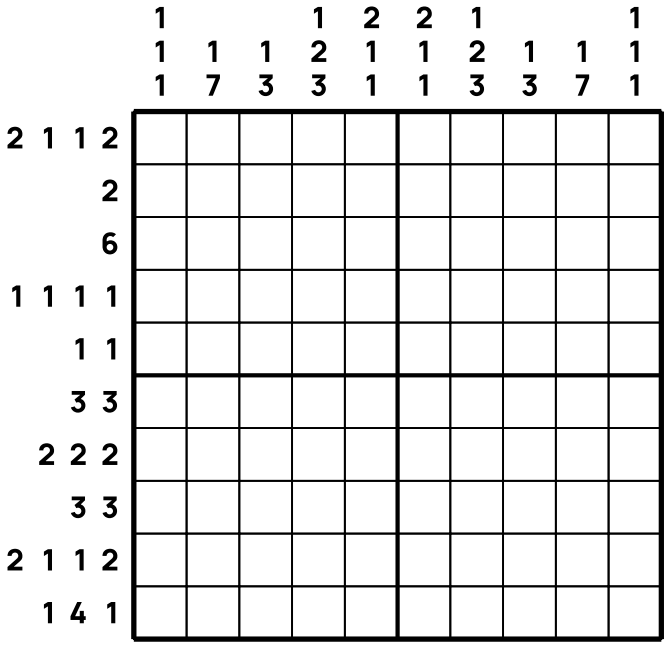

2.

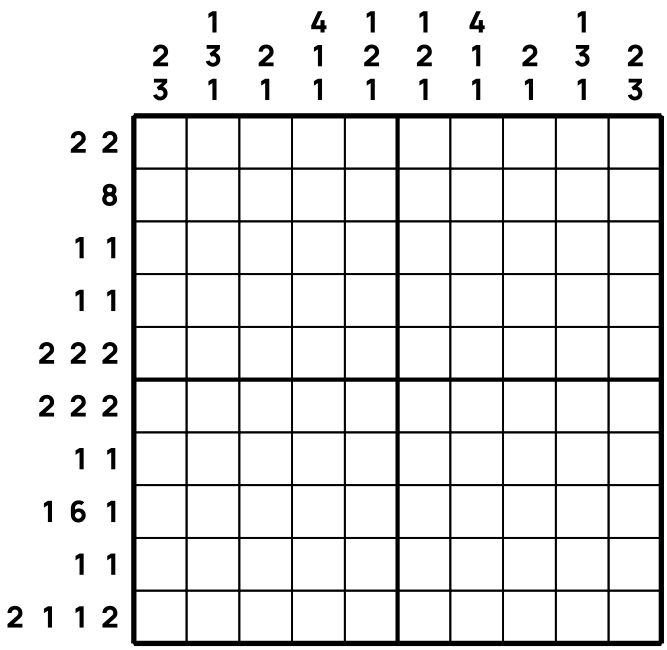

네모로직

5단계 어려움 · 3번

이름 _____ 날짜 _____

줄마다 적힌 숫자만큼 칸을 이어서 칠하세요. 숫자가 둘 이상이면 사이를 한 칸 이상 띄웁니다.

1.

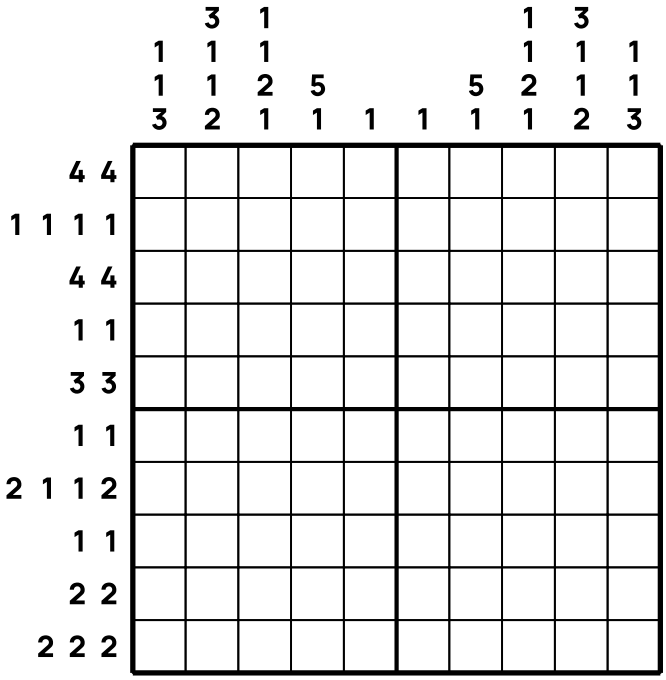

2.

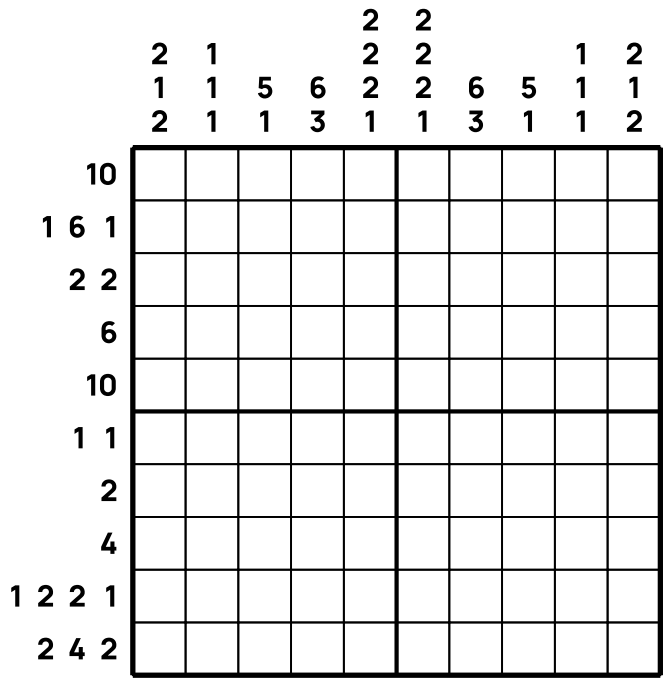

네모로직

5단계 어려움 · 4번

이름 _____ 날짜 _____

줄마다 적힌 숫자만큼 칸을 이어서 칠하세요. 숫자가 둘 이상이면 사이를 한 칸 이상 띄웁니다.

1.

	6 1	2 3 2	2 4 1	1 2	1 2 3	1 2 3	1 2	2 4 1	2 3 2	6 1
3 3										
3 2 3										
1 1										
10										
3 2 3										
3 3										
1 1										
4										
1 4 1										
3 2 3										

2.

	1 1 1	1 1 1	3 2 1	5 1	2 1 1	2 1 1	5 1	3 2 1	1 1 1	1 1 1
1 2 1										
2 2 2										
1 1										
8										
1 1										
1 2 2 1										
8										
1 1										
1 1 1 1										
1 4 1										

네모로직 정답

5단계 어려움 · 1번

이름 _____ 날짜 _____

1.

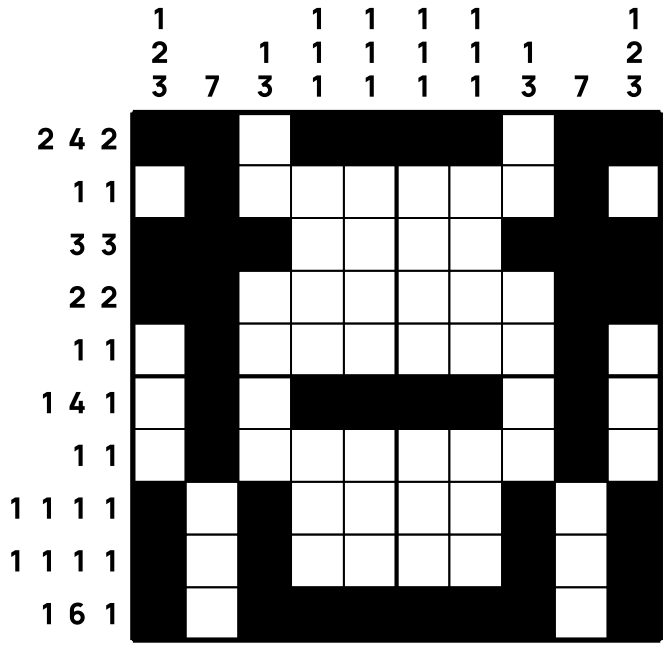

2.



네모로직 정답

5단계 어려움 · 2번

이름 _____ 날짜 _____

1.

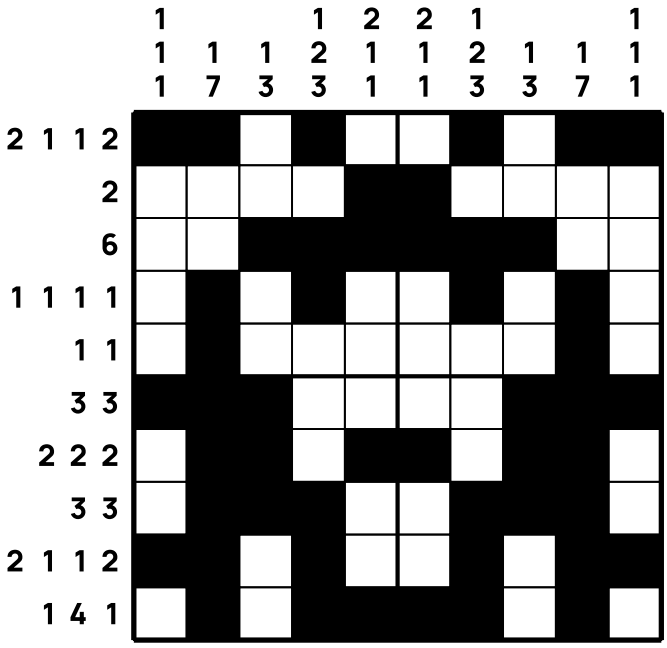

2.

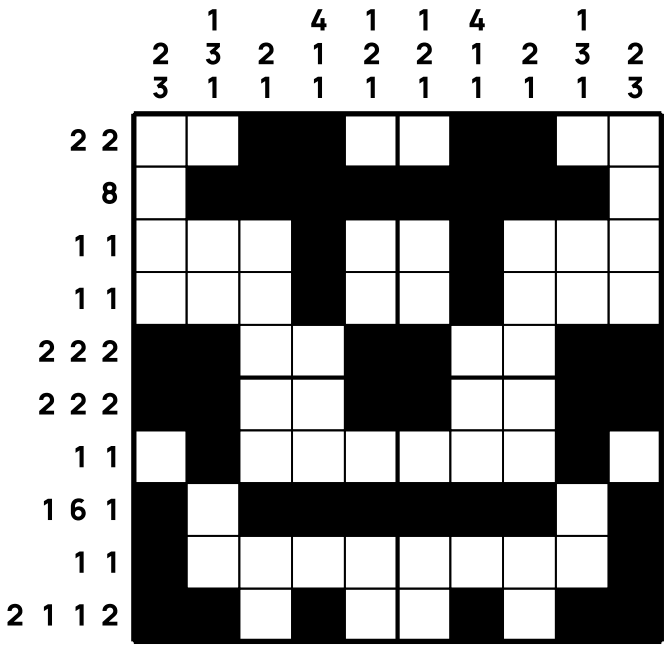

네모로직 정답

5단계 어려움 · 3번

이름 _____ 날짜 _____

1.



2.

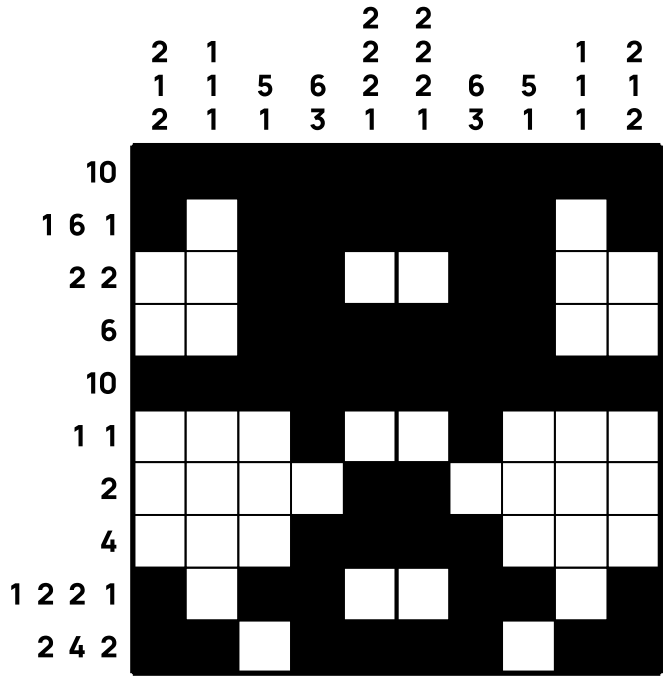

네모로직 정답

5단계 어려움 · 4번

이름 _____ 날짜 _____

1.



2.

